MusIQ Club Assessment: Level 6

Written Test

Name: _____

Write an E Harmonic Minor scale in the treble clef using whole notes:



/3

Write an A Melodic Minor scale in the bass clef using whole notes, ascending and descending:



/4

Write a 2/4 Time Signature, and compose a rhythm using at least 2 different eighth note/sixteenth notes combinations, and at least one dotted eighth note.



/6

Name the following major key signatures:



Ex. D Major _____ _____ _____ _____

/8

What is the Order of the Sharps? _____

What is the name for a pattern of 4 notes that follow the pattern Tone Tone Semitone?_____

/4

Total /25

Copyright © Adventus Inc 2009. For MusIQ Club use only.